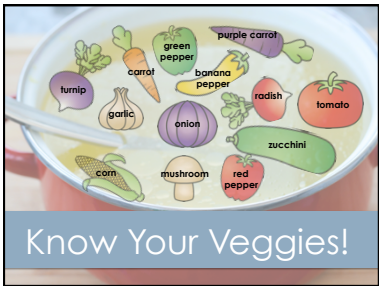

Question 1

There were twice as many students out sick on Thursday as on Monday and everyone was present on Friday. How many students were out sick this week?

Number of Students Out Sick	
Monday	4
Tuesday	6
Wednesday	2

Answer

Answer 1

20 students



Chef's Choice

Question 2

How many of the public buses have at least 25 people on them?

People on a Public Bus

stem	leaves
1	5 5
2	1 3 7
3	0
4	1 4

1 | 5 represents 15

Answer

Answer 2

4 buses



Chef's Choice