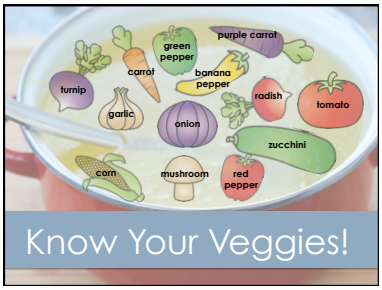

Question 1

There are four times as many red cars in a parking lot than blue cars. There are three times as many blue cars in the parking lot than silver cars. There are 48 red cars in the parking lot. How many silver cars are there in the parking lot?

Answer

Answer 1

4 silver cars



Chef's Choice

Question 2

Charlie has $64 in his wallet. He wants to buy as many pies as he can. Each pie is $8.
How many pies is he able to buy?

Answer

Answer 2

8 pies



Chef's Choice